Name : _____

Topic: Math – Model Approach – Addition and Subtraction

SCHOOLKID.PH
http://www.schoolkid.ph

Contributor : RFAquino

DIRECTIONS: Study the model. Write a number sentence to represent each relationship. Solve for the missing number in the model.

Note: Rectangular models not drawn to scale.

(1)

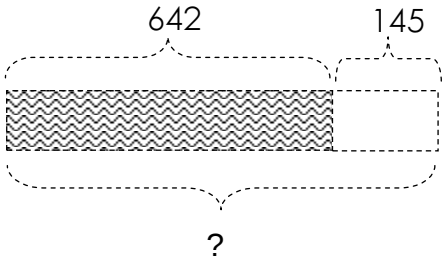

☐ ○ ☐ = ?

Solution:

(3)

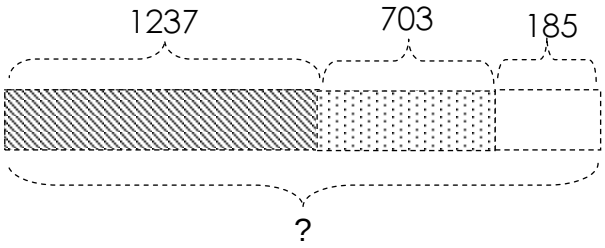

☐ ○ ☐ ○ ☐ = ?

Solution:

(2)

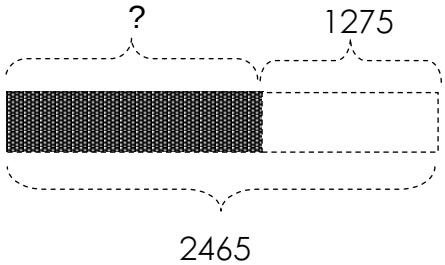

☐ ○ ☐ = ?

Solution:

(4)

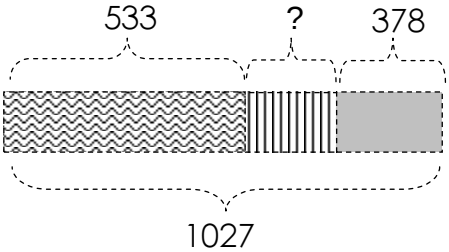

☐ ○ ☐ = ☐

☐ ○ ☐ = ?

Solutions:

Copyright 2009 www.schoolkid.ph All Rights Reserved. For Personal Use Only.